Facteurs Premiers (J)

Utilisez un diagramme à branches pour trouver les facteurs premiers des nombres suivants.

203

82

105

112

84

95

119

196

58

Facteurs Premiers (J) Solutions

Utilisez un diagramme à branches pour trouver les facteurs premiers des nombres suivants.

203

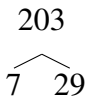

$203 = 7 \times 29$

82

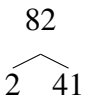

$82 = 2 \times 41$

105

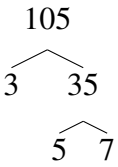

$105 = 3 \times 5 \times 7$

112

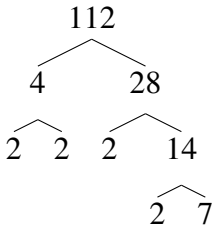

$112 = 2^4 \times 7$

84

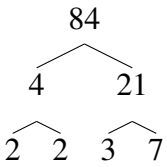

$84 = 2^2 \times 3 \times 7$

95

$95 = 5 \times 19$

119

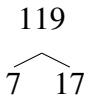

$119 = 7 \times 17$

196

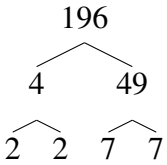

$196 = 2^2 \times 7^2$

58

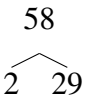

$58 = 2 \times 29$