Facteurs Premiers (I)

Utilisez un diagramme à branches pour trouver les facteurs premiers des nombres suivants.

215

102

88

52

130

212

205

146

91

Facteurs Premiers (I) Solutions

Utilisez un diagramme à branches pour trouver les facteurs premiers des nombres suivants.

215

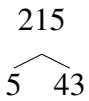

$215 = 5 \times 43$

102

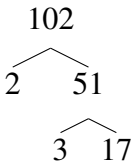

$102 = 2 \times 3 \times 17$

88

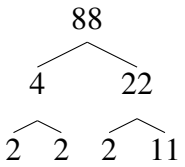

$88 = 2^3 \times 11$

52

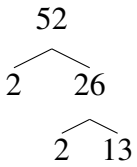

$52 = 2^2 \times 13$

130

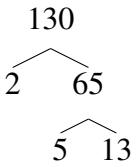

$130 = 2 \times 5 \times 13$

212

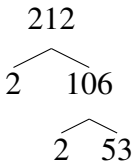

$212 = 2^2 \times 53$

205

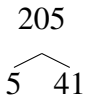

$205 = 5 \times 41$

146

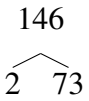

$146 = 2 \times 73$

91

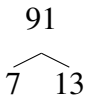

$91 = 7 \times 13$