Facteurs Premiers (B)

Utilisez un diagramme à branches pour trouver les facteurs premiers des nombres suivants.

128

169

155

76

76

196

115

119

129

Facteurs Premiers (B) Solutions

Utilisez un diagramme à branches pour trouver les facteurs premiers des nombres suivants.

128

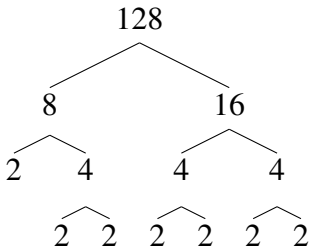

$128 = 2^7$

169

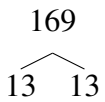

$169 = 13^2$

155

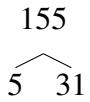

$155 = 5 \times 31$

76

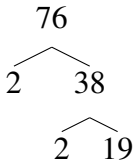

$76 = 2^2 \times 19$

76

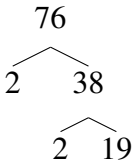

$76 = 2^2 \times 19$

196

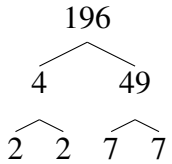

$196 = 2^2 \times 7^2$

115

$115 = 5 \times 23$

119

$119 = 7 \times 17$

129

$129 = 3 \times 43$