Facteurs Premiers (J)

Utilisez un diagramme à branches pour trouver les facteurs premiers des nombres suivants.

38

121

76

121

129

133

33

36

24

Facteurs Premiers (J) Solutions

Utilisez un diagramme à branches pour trouver les facteurs premiers des nombres suivants.

38

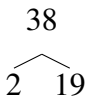

$38 = 2 \times 19$

121

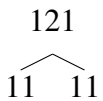

$121 = 11^2$

76

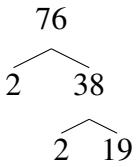

$76 = 2^2 \times 19$

121

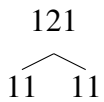

$121 = 11^2$

129

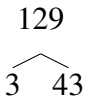

$129 = 3 \times 43$

133

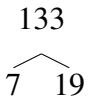

$133 = 7 \times 19$

33

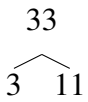

$33 = 3 \times 11$

36

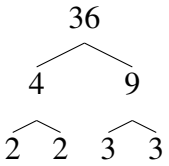

$36 = 2^2 \times 3^2$

24

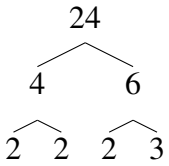

$24 = 2^3 \times 3$