# Facteurs Premiers (I)

Utilisez un diagramme à branches pour trouver les facteurs premiers des nombres suivants.

102

16

58

20

56

119

50

81

121

# Facteurs Premiers (I) Solutions

Utilisez un diagramme à branches pour trouver les facteurs premiers des nombres suivants.

102

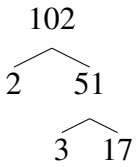


$102 = 2 \times 3 \times 17$

16

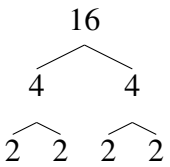


$16 = 2^4$

58

$58 = 2 \times 29$

20

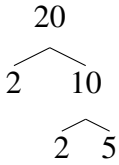


$20 = 2^2 \times 5$

56

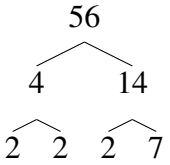


$56 = 2^3 \times 7$

119

$119 = 7 \times 17$

50

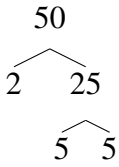


$50 = 2 \times 5^2$

81

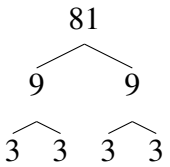


$81 = 3^4$

121

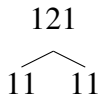


$121 = 11^2$