Facteurs Premiers (D)

Utilisez un diagramme à branches pour trouver les facteurs premiers des nombres suivants.

46 84 91

14 95 91

88 35 40

Facteurs Premiers (D) Solutions

Utilisez un diagramme à branches pour trouver les facteurs premiers des nombres suivants.

46

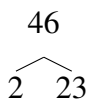

$46 = 2 \times 23$

84

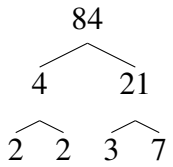

$84 = 2^2 \times 3 \times 7$

91

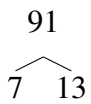

$91 = 7 \times 13$

14

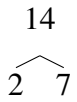

$14 = 2 \times 7$

95

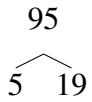

$95 = 5 \times 19$

91

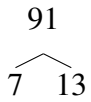

$91 = 7 \times 13$

88

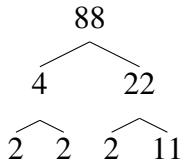

$88 = 2^3 \times 11$

35

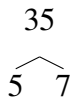

$35 = 5 \times 7$

40

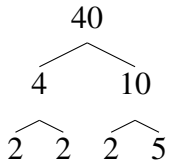

$40 = 2^3 \times 5$