# Lecture d'Horloge Analogue (I)

Lisez le temps indiqué et inscrivez le sous l'horloge.

1.


2.


3.


4.


5.


6.


7.


8.


9.


10.


11.


12.


# Lecture d'Horloge Analogue (I) Solutions

Lisez le temps indiqué et inscrivez le sous l'horloge.

1.

2:00

2.

12:00

3.

3:00

4.

12:30

5.

9:00

6.

2:00

7.

10:00

8.

11:00

9.

1:30

10.

3:00

11.
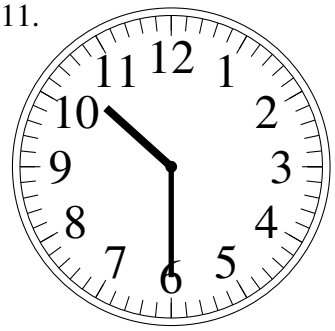
10:30

12.

2:00