Aire et Périmètre de Rectangles (D)

Trouvez l'aire et le périmètre de chaque rectangle.

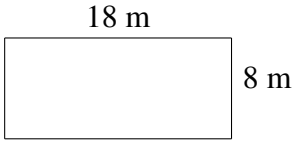

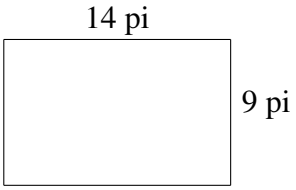

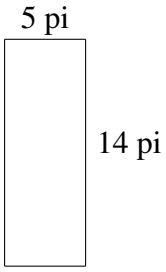



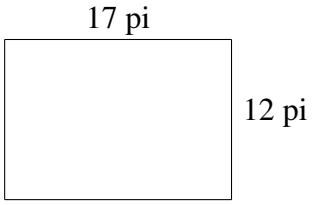



Aire et Périmètre de Rectangles (D) Solutions

Trouvez l'aire et le périmètre de chaque rectangle.

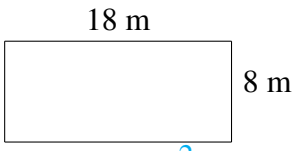

A = 144 m^2
P = 52 m

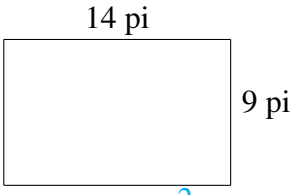

A = 126 pi^2
P = 46 pi

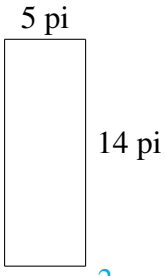

A = 70 pi^2
P = 38 pi



A = 85 m^2
P = 44 m

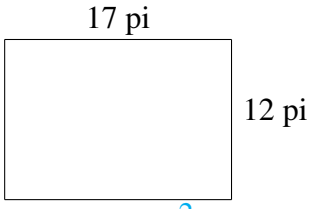

A = 204 pi^2
P = 58 pi



A = 152 pi^2
P = 54 pi