Aire et Périmètre de Parallélogrammes (C)

Trouvez l'aire et le périmètre de chaque parallélogramme.

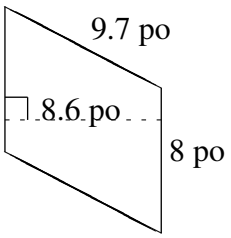

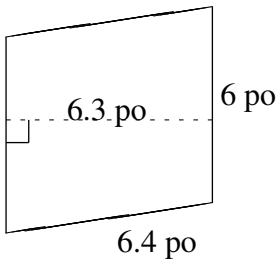

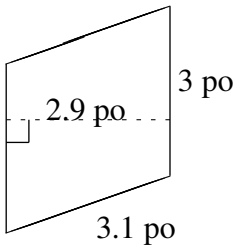

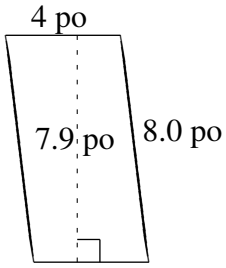

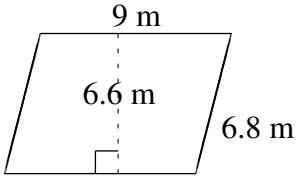

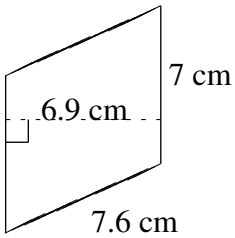

Aire et Périmètre de Parallélogrammes (C) Solutions

Trouvez l'aire et le périmètre de chaque parallélogramme.

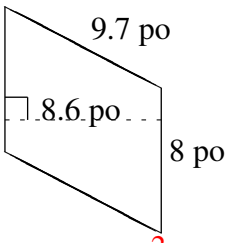

A = 68.8 po^2
P = 35.4 po

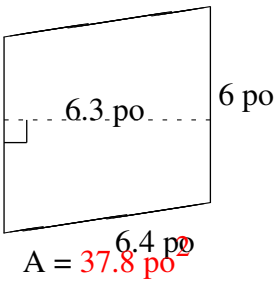

A = 37.8 po^2
P = 24.8 po

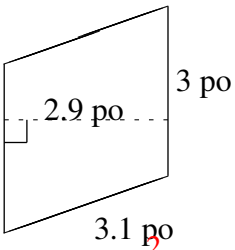

A = 8.7 po^2
P = 12.2 po

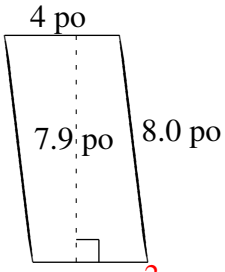

A = 31.6 po^2
P = 24.0 po

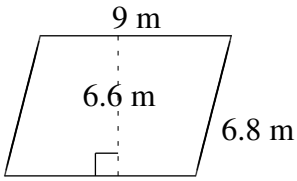

A = 59.4 m^2
P = 31.6 m

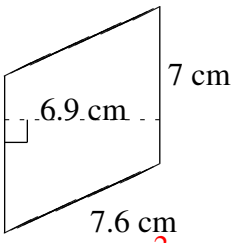

A = 48.3 cm^2
P = 29.2 cm