Aire et Périmètre d'un Triangle (D)

Calculez l'aire et le périmètre des triangles à l'aide de la formule de Héron.

1.

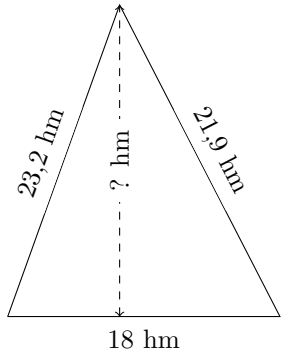

P = ? hm
A = ? hm^2

2.

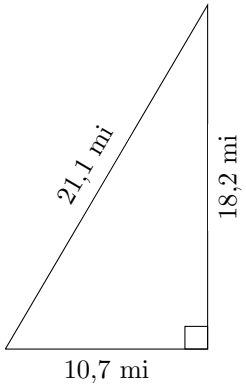

P = ? mi
A = ? mi^2

3.

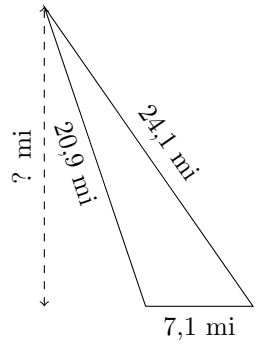

P = ? mi
A = ? mi^2

4.

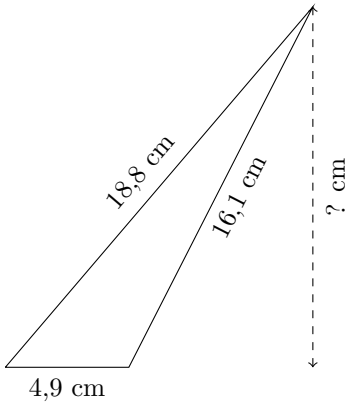

P = ? cm
A = ? cm^2

5.

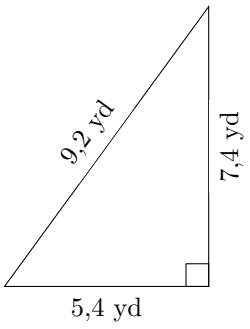

P = ? yd
A = ? yd^2

6.

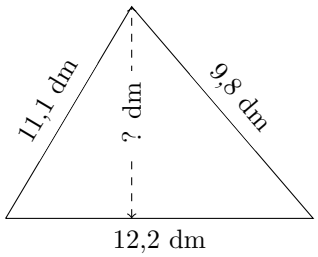

P = ? dm
A = ? dm^2

Aire et Périmètre d'un Triangle (D) Réponses

Calculez l'aire et le périmètre des triangles à l'aide de la formule de Héron.

1.

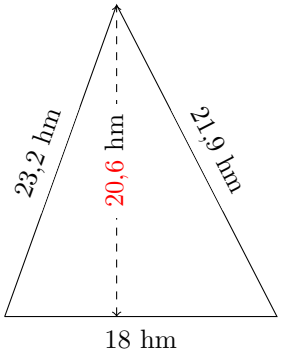

P = 63,1 hm
A = 185,599 hm^2

2.

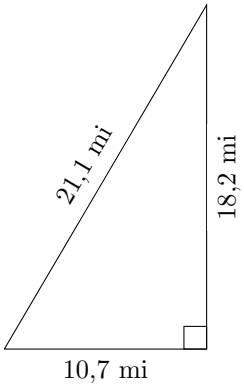

P = 50 mi
A = 97,37 mi^2

3.

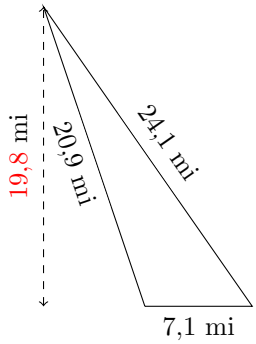

P = 52,1 mi
A = 70,409 mi^2

4.

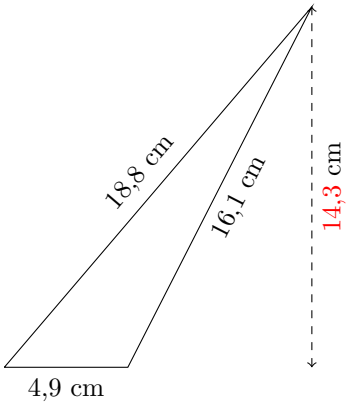

P = 39,8 cm
A = 35,323 cm^2

5.

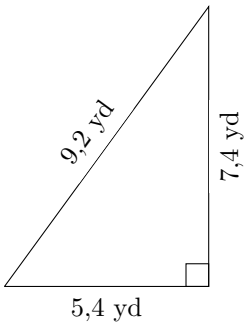

P = 22 yd
A = 19,979 yd^2

6.

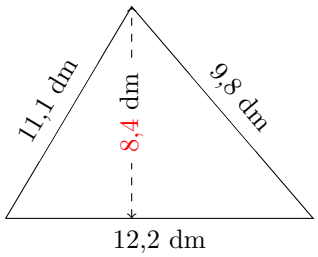

P = 33,1 dm
A = 51,463 dm^2