Aire et Hauteur d'un Triangle Rectangle (A)

Calculez l'aire et la hauteur de chaque triangle rectangle.

1.

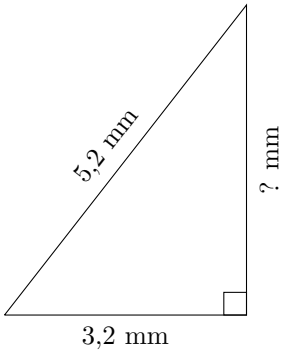

P = 12,5 mm
A = ? mm^2

2.

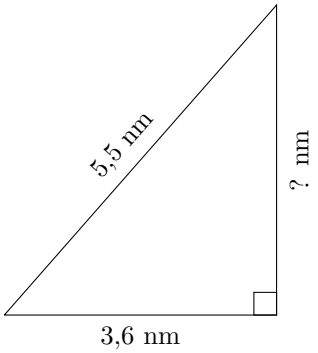

P = 13,2 nm
A = ? nm^2

3.

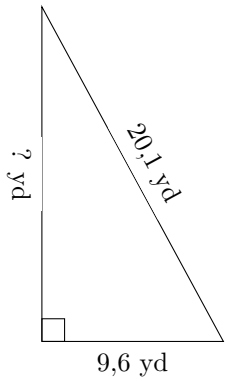

P = 47,4 yd
A = ? yd^2

4.

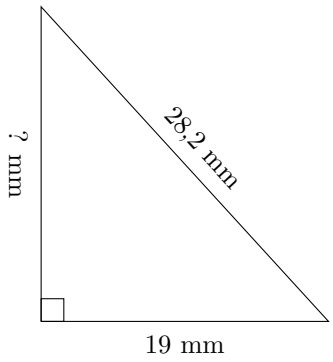

P = 68 mm
A = ? mm^2

5.

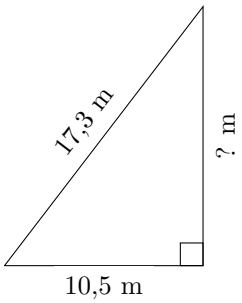

P = 41,5 m
A = ? m^2

6.

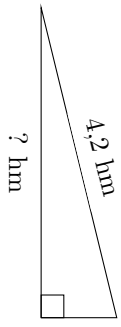

P = 9,3 hm
A = ? hm^2

Aire et Hauteur d'un Triangle Rectangle (A) Réponses

Calculez l'aire et la hauteur de chaque triangle rectangle.

1.

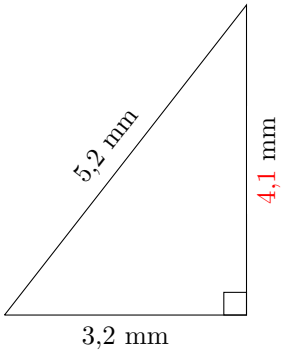

P = 12,5 mm
A = 6,56 mm^2

2.

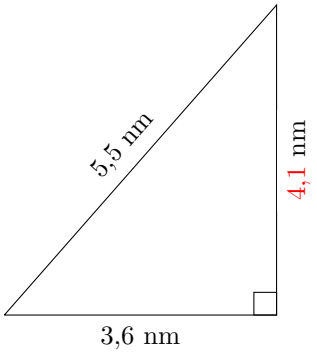

P = 13,2 nm
A = 7,38 nm^2

3.

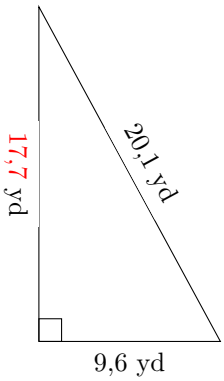

P = 47,4 yd
A = 84,96 yd^2

4.

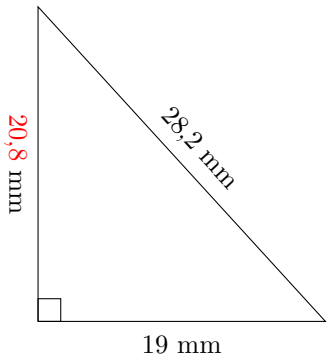

P = 68 mm
A = 197,6 mm^2

5.

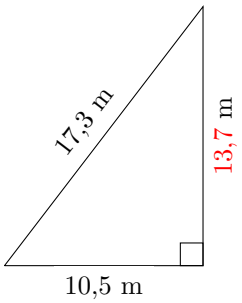

P = 41,5 m
A = 71,925 m^2

6.

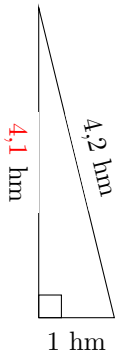

P = 9,3 hm
A = 2,05 hm^2