Lignes Perpendiculaires (H)

Construisez une ligne perpendiculaire au segment passant par le point sans étiquette.

1.



2.

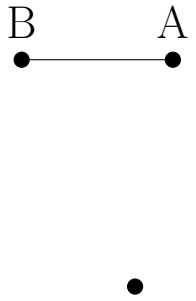

3.

4.

Lignes Perpendiculaires (H) Solutions

Construisez une ligne perpendiculaire au segment passant par le point sans étiquette.

1.

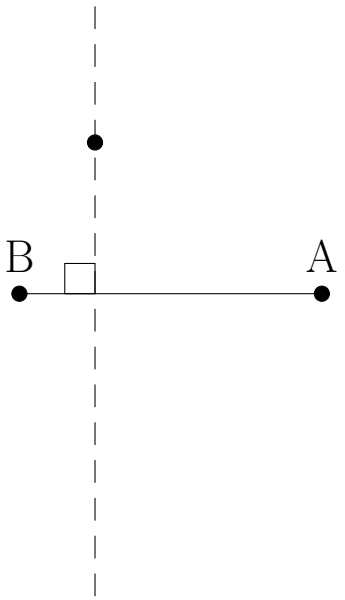

2.

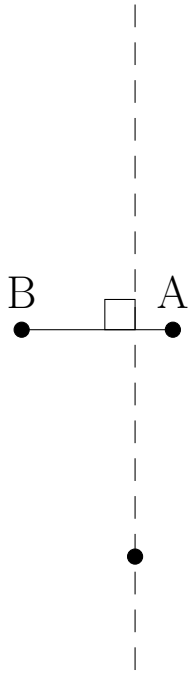

3.

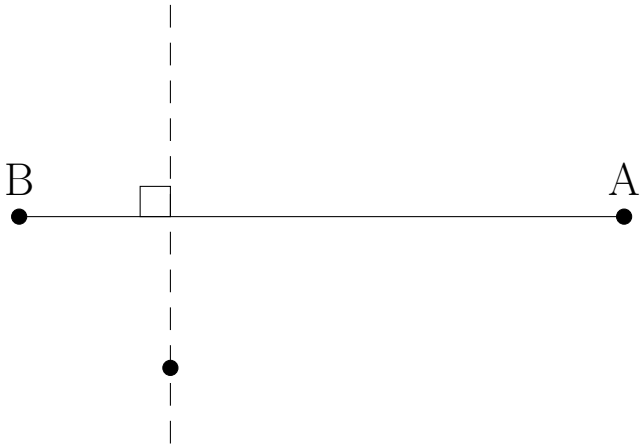

4.