Lignes Perpendiculaires (F)

Construisez une ligne perpendiculaire au segment passant par le point sans étiquette.

1.

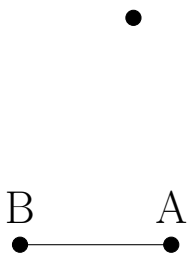

2.

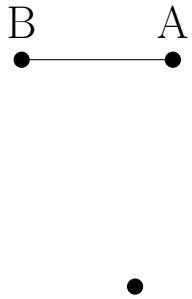

3.
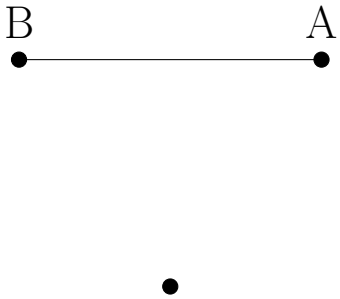
4.