Rapports Trigonométriques (A)

Nom: _____ Date: _____

Trouvez la mesure d'un angle ou d'un côté avec les rapports triogonométriques.

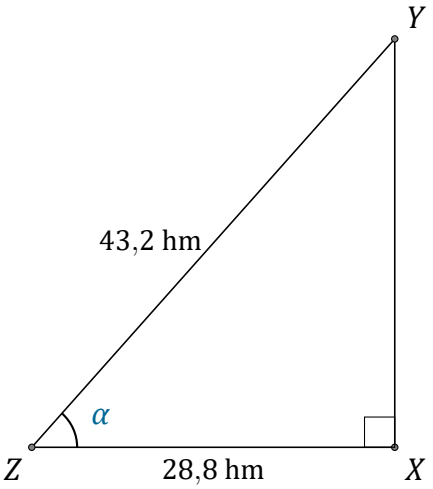

$\alpha = \angle XZY =$ _____

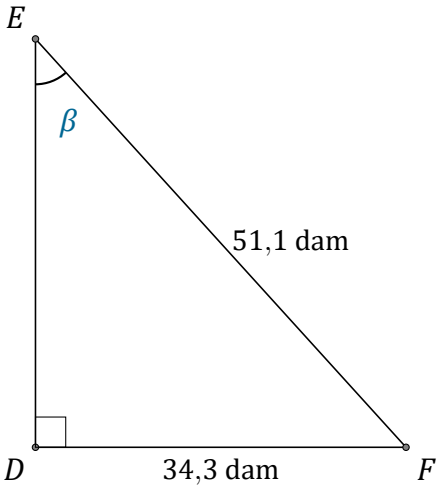

$\beta = \angle DEF =$ _____

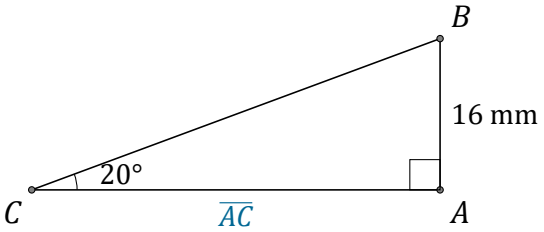

$\overline{AC} =$ _____

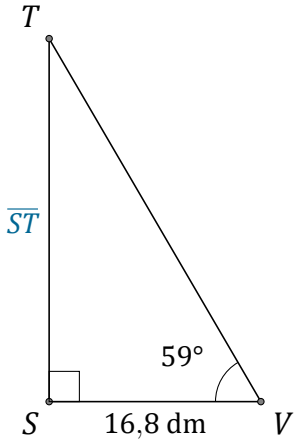

$\overline{ST} =$ _____