Calcul de l'Aire et Circonférence (G)

Calculez les mesures de chaque cercles à l'aide de la mesure donnée. Utlisez pi = 3.14

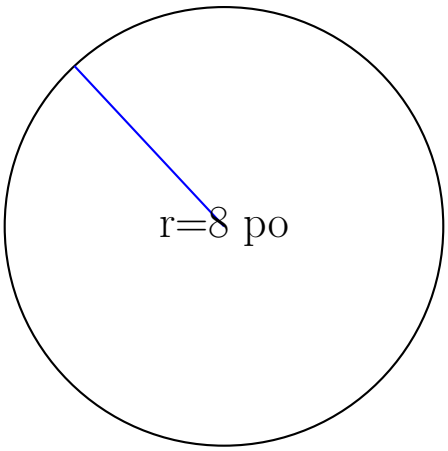

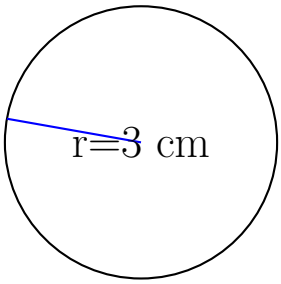

circonférence = _____

aire = _____

circonférence = _____

aire = _____

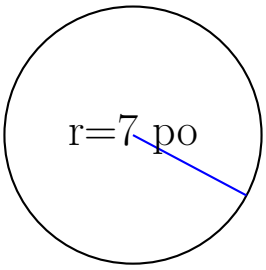

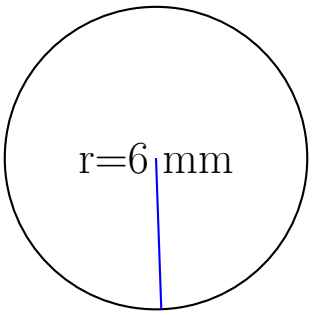

circonférence = _____

aire = _____

circonférence = _____

aire = _____