Calcul de l'Aire et Circonférence (F)

Calculez les mesures de chaque cercles à l'aide de la mesure donnée. Utlisez pi = 3.14

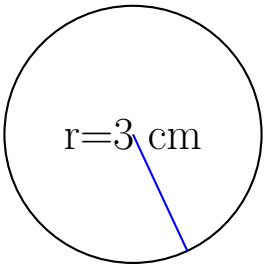

circonférence = _____

aire = _____

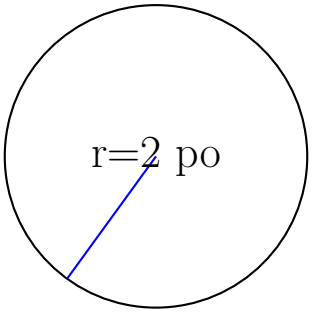

circonférence = _____

aire = _____

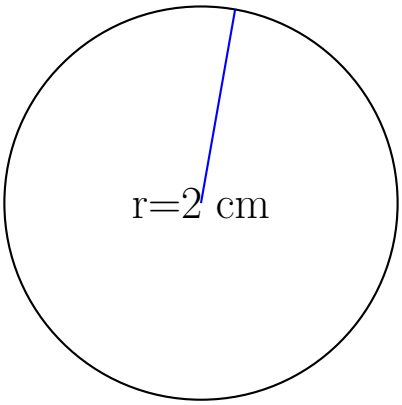

circonférence = _____

aire = _____

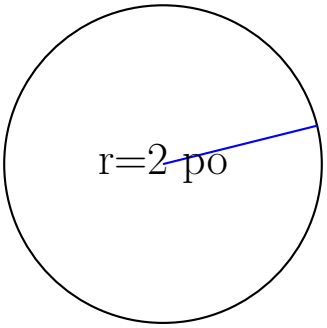

circonférence = _____

aire = _____

Calcul de l'Aire et Circonférence (F) Solutions

Calculez les mesures de chaque cercles à l'aide de la mesure donnée. Utlisez pi = 3.14

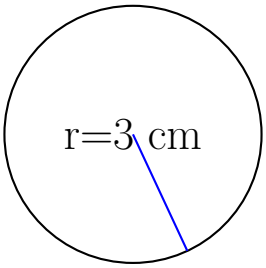

circonférence = 18.84 cm

aire = 28.26 cm^2

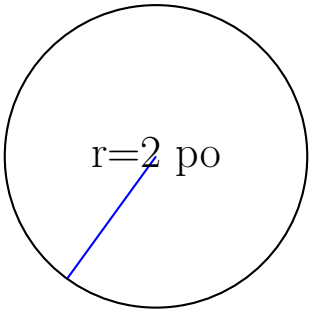

circonférence = 12.56 po

aire = 12.56 po^2

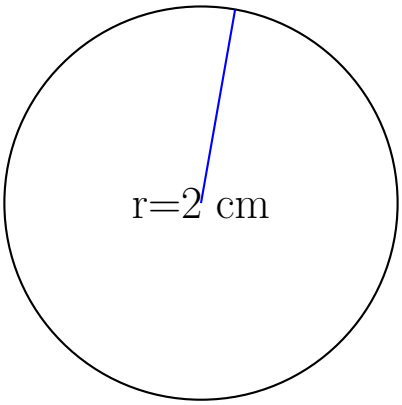

circonférence = 12.56 cm

aire = 12.56 cm^2

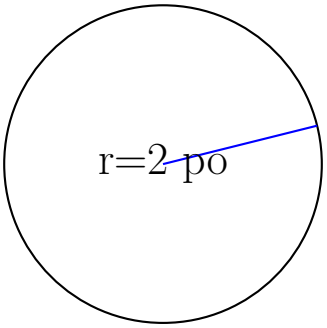

circonférence = 12.56 po

aire = 12.56 po^2