Calcul de l'Aire et Circonférence (J)

Calculez les mesures de chaque cercles à l'aide de la mesure donnée. Utlisez pi = 3.14

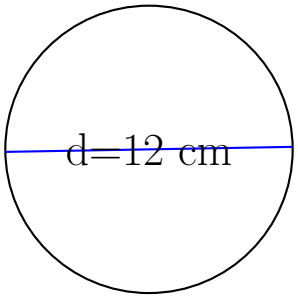

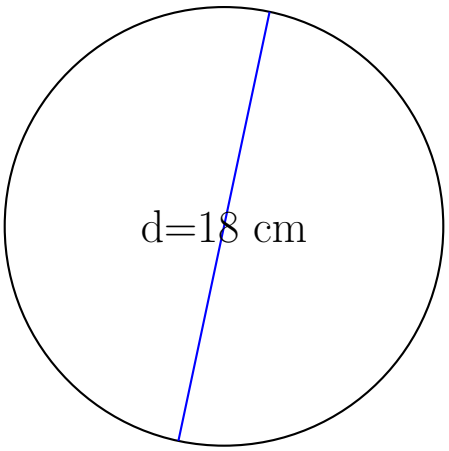

circonférence = _____

aire = _____

circonférence = _____

aire = _____

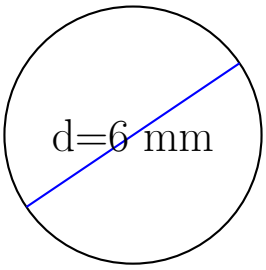

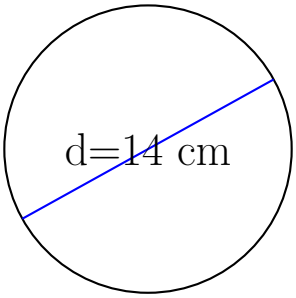

circonférence = _____

aire = _____

circonférence = _____

aire = _____

Calcul de l'Aire et Circonférence (J) Solutions

Calculez les mesures de chaque cercles à l'aide de la mesure donnée. Utlisez pi = 3.14

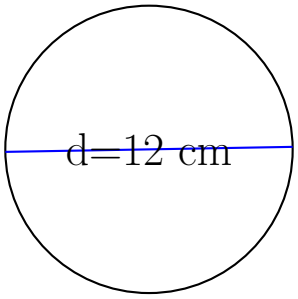

circonférence = 37.68 cm

aire = 113.04 cm^2

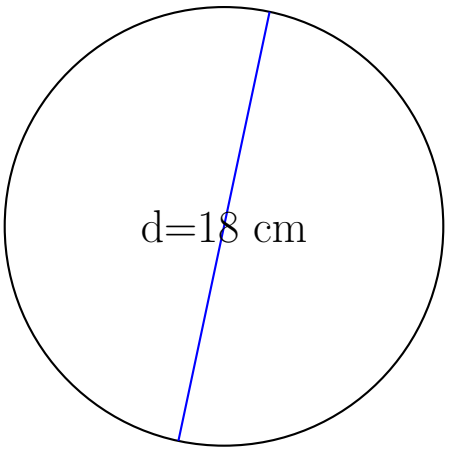

circonférence = 56.52 cm

aire = 254.34 cm^2

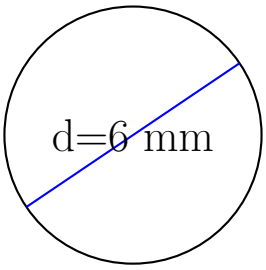

circonférence = 18.84 mm

aire = 28.26 mm^2

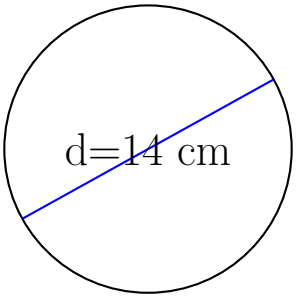

circonférence = 43.96 cm

aire = 153.86 cm^2