Calcul de l'Aire et Circonférence (B)

Calculez les mesures de chaque cercles à l'aide de la mesure donnée. Utlisez pi = 3.14

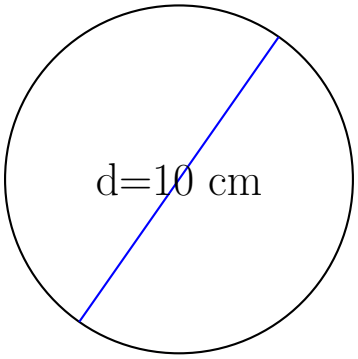

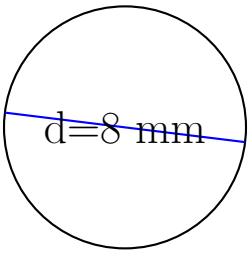

circonférence = _____

aire = _____

circonférence = _____

aire = _____

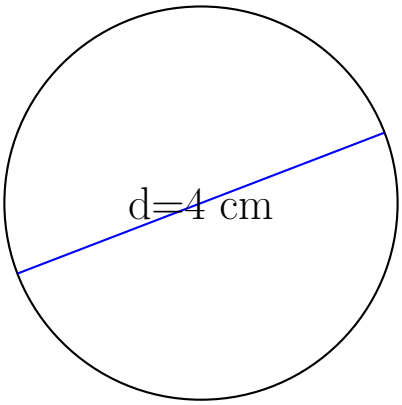

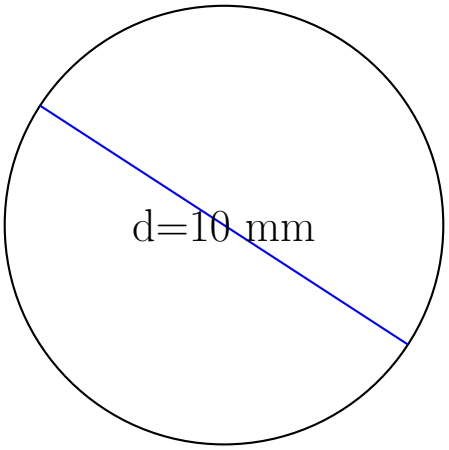

circonférence = _____

aire = _____

circonférence = _____

aire = _____

Calcul de l'Aire et Circonférence (B) Solutions

Calculez les mesures de chaque cercles à l'aide de la mesure donnée. Utlisez pi = 3.14

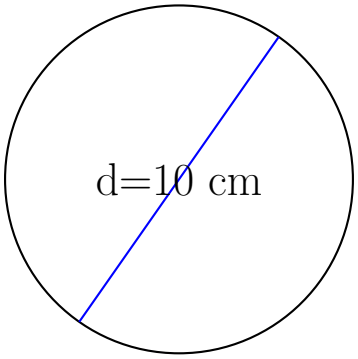

circonférence = 31.4 cm

aire = 78.5 cm^2

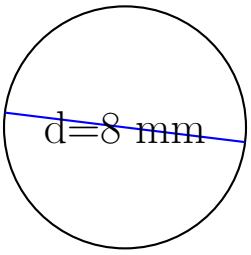

circonférence = 25.12 mm

aire = 50.24 mm^2

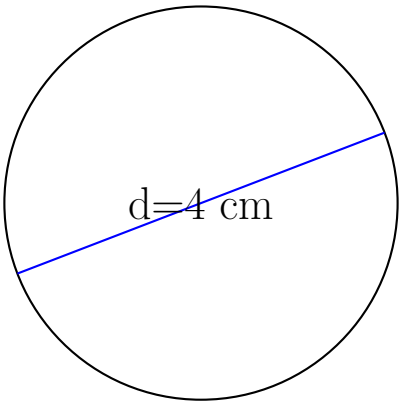

circonférence = 12.56 cm

aire = 12.56 cm^2

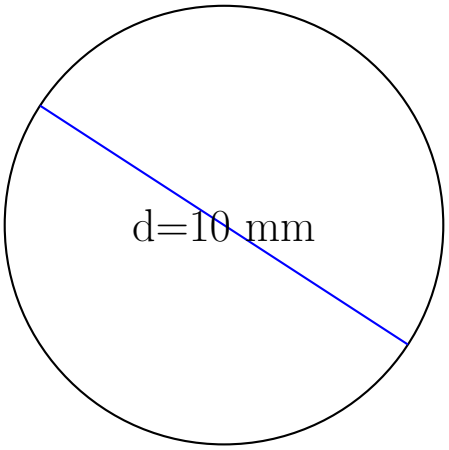

circonférence = 31.4 mm

aire = 78.5 mm^2