Calcul de l'Aire et Circonférence (I)

Calculez les mesures de chaque cercles à l'aide de la mesure donnée. Utlisez pi = 3.14

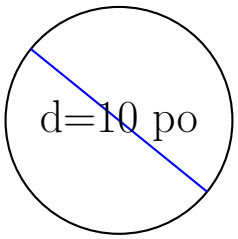

circonférence = _____

aire = _____

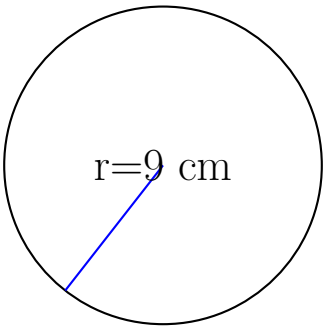

circonférence = _____

aire = _____

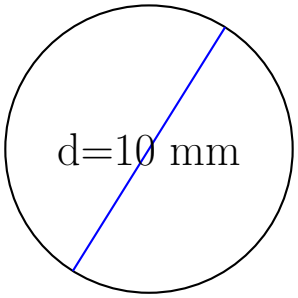

circonférence = _____

aire = _____

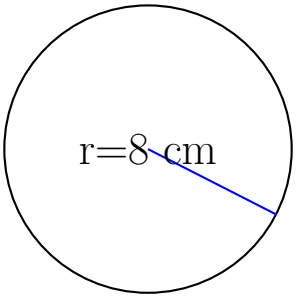

circonférence = _____

aire = _____