Calcul de l'Aire et Circonférence (I)

Calculez les mesures de chaque cercles à l'aide de la mesure donnée. Utlisez pi = 3.14

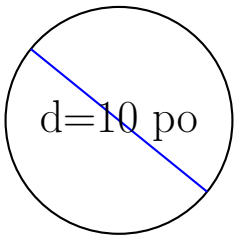

circonférence = _____

aire = _____

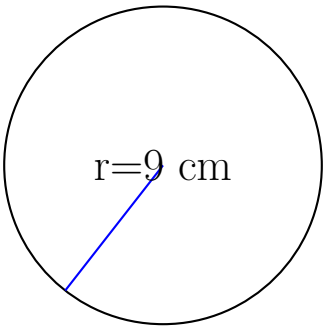

circonférence = _____

aire = _____

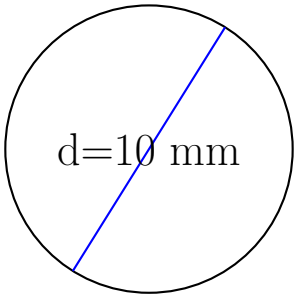

circonférence = _____

aire = _____

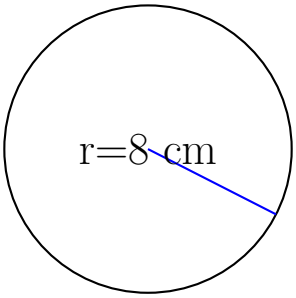

circonférence = _____

aire = _____

Calcul de l'Aire et Circonférence (I) Solutions

Calculez les mesures de chaque cercles à l'aide de la mesure donnée. Utlisez pi = 3.14

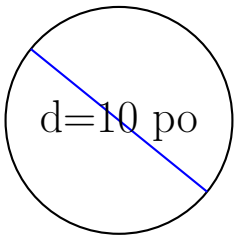

circonférence = 31.4 po

aire = 78.5 po^2

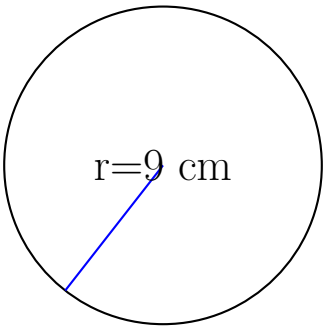

circonférence = 56.52 cm

aire = 254.34 cm^2

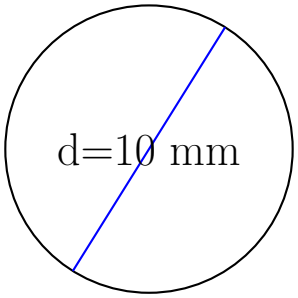

circonférence = 31.4 mm

aire = 78.5 mm^2

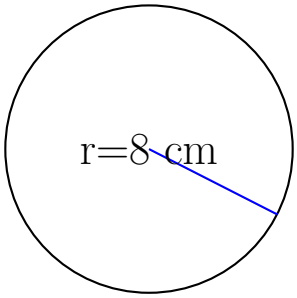

circonférence = 50.24 cm

aire = 200.96 cm^2