Modèles d'un Ensemble (G)



Dans cet ensemble il y a 20 figures et 10 sont coloriées.

$$\frac{\text{10 figures coloriées}}{\text{20 figures dans cet ensemble}} = \frac{10}{20} = \frac{1}{2}$$
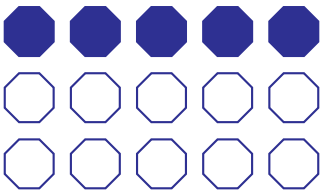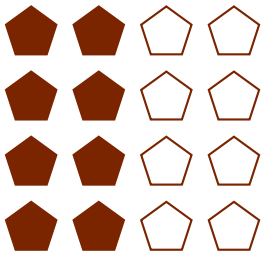
Écrivez une fraction pour chacun des modèles suivants.