Modèles d'un Ensemble (J)



Dans cet ensemble il y a 16 figures et 12 sont coloriées.

$$\frac{\text{12 figures coloriées}}{\text{16 figures dans cet ensemble}} = \frac{12}{16} = \frac{3}{4}$$

Écrivez une fraction pour chacun des modèles suivants.