Modèles d'un Ensemble (J)



Dans cet ensemble il y a 16 figures et 12 sont coloriées.

$$\frac{\text{12 figures coloriées}}{\text{16 figures dans cet ensemble}} = \frac{12}{16} = \frac{3}{4}$$

Écrivez une fraction pour chacun des modèles suivants.







Modèles d'un Ensemble (J) Réponses



Dans cet ensemble il y a 16 figures et 12 sont coloriées.

$$\frac{\text{12 figures coloriées}}{\text{16 figures dans cet ensemble}} = \frac{12}{16} = \frac{3}{4}$$

Écrivez une fraction pour chacun des modèles suivants.

$$\frac{4}{8} = \frac{1}{2}$$

$$\frac{6}{8} = \frac{3}{4}$$



$$\frac{4}{16} = \frac{1}{4}$$

$$\frac{6}{12} = \frac{1}{2}$$

$$\frac{3}{4}$$



$$\frac{10}{20} = \frac{1}{2}$$



$$\frac{5}{20} = \frac{1}{4}$$

$$\frac{1}{3}$$