Modèles d'un Ensemble (G)



Dans cet ensemble il y a 9 figures et 6 sont coloriées.

$$\frac{\text{6 figures coloriées}}{\text{9 figures dans cet ensemble}} = \frac{6}{9} = \frac{2}{3}$$

Écrivez une fraction pour chacun des modèles suivants.