Modèles d'un Ensemble (I)



Dans cet ensemble
il y a 24 figures
et 8 sont coloriées.

$$\frac{\text{8 figures coloriées}}{\text{24 figures dans cet ensemble}} = \frac{8}{24} = \frac{1}{3}$$
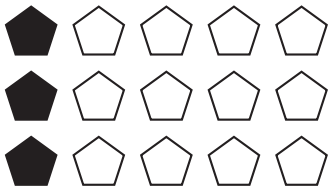
Écrivez une fraction pour chacun des modèles suivants.