Modèles d'un Ensemble (I)



Dans cet ensemble
il y a 24 figures
et 8 sont coloriées.

$$\frac{\text{8 figures coloriées}}{\text{24 figures dans cet ensemble}} = \frac{8}{24} = \frac{1}{3}$$

Écrivez une fraction pour chacun des modèles suivants.







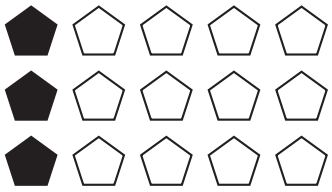





Modèles d'un Ensemble (I) Réponses



Dans cet ensemble
il y a 24 figures
et 8 sont coloriées.

$$\frac{\text{8 figures coloriées}}{\text{24 figures dans cet ensemble}} = \frac{8}{24} = \frac{1}{3}$$

Écrivez une fraction pour chacun des modèles suivants.



$$\frac{6}{8} = \frac{3}{4}$$

$$\frac{2}{3}$$



$$\frac{16}{20} = \frac{4}{5}$$

$$\frac{6}{18} = \frac{1}{3}$$



$$\frac{12}{20} = \frac{3}{5}$$

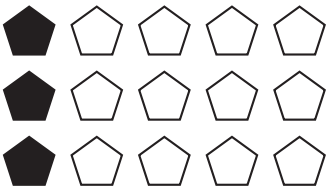

$$\frac{3}{15} = \frac{1}{5}$$



$$\frac{10}{20} = \frac{1}{2}$$



$$\frac{8}{20} = \frac{2}{5}$$