Modèles d'un Ensemble (C)



Dans cet ensemble
il y a 18 figures
et 6 sont coloriées.

$$\frac{\text{6 figures coloriées}}{\text{18 figures dans cet ensemble}} = \frac{6}{18} = \frac{1}{3}$$
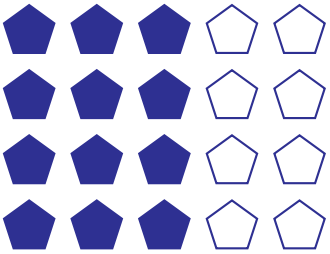
Écrivez une fraction pour chacun des modèles suivants.