Modèles d'un Ensemble (C)



Dans cet ensemble
il y a 18 figures
et 6 sont coloriées.

$$\frac{\text{6 figures coloriées}}{\text{18 figures dans cet ensemble}} = \frac{6}{18} = \frac{1}{3}$$

Écrivez une fraction pour chacun des modèles suivants.





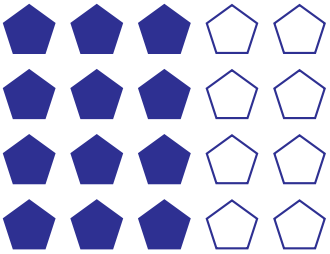



Modèles d'un Ensemble (C) Réponses



Dans cet ensemble il y a 18 figures et 6 sont coloriées.

$$\frac{\text{6 figures coloriées}}{\text{18 figures dans cet ensemble}} = \frac{6}{18} = \frac{1}{3}$$

Écrivez une fraction pour chacun des modèles suivants.

$$\frac{4}{6} = \frac{2}{3}$$

$$\frac{2}{10} = \frac{1}{5}$$



$$\frac{3}{12} = \frac{1}{4}$$



$$\frac{8}{16} = \frac{1}{2}$$

$$\frac{4}{5}$$

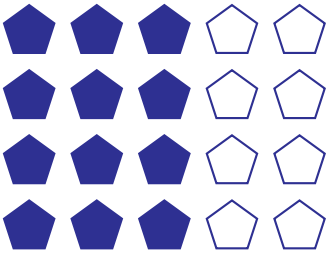

$$\frac{12}{20} = \frac{3}{5}$$

$$\frac{4}{10} = \frac{2}{5}$$

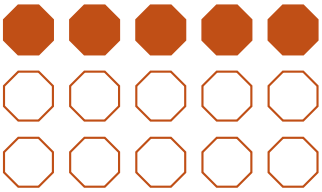

$$\frac{5}{15} = \frac{1}{3}$$