Modèles d'un Ensemble (A)

Dans cet ensemble
il y a 10 figures
et 8 sont coloriées.

$$\frac{\text{8 figures coloriées}}{\text{10 figures dans cet ensemble}} = \frac{8}{10} = \frac{4}{5}$$
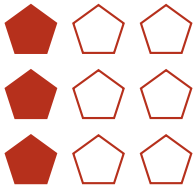
Écrivez une fraction pour chacun des modèles suivants.