Modèles d'un Ensemble (A)

Dans cet ensemble
il y a 10 figures
et 8 sont coloriées.

$$\frac{\text{8 figures coloriées}}{\text{10 figures dans cet ensemble}} = \frac{8}{10} = \frac{4}{5}$$

Écrivez une fraction pour chacun des modèles suivants.











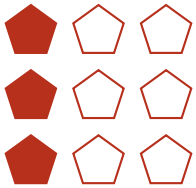

Modèles d'un Ensemble (A) Réponses

Dans cet ensemble
il y a 10 figures
et 8 sont coloriées.

$$\frac{\text{8 figures coloriées}}{\text{10 figures dans cet ensemble}} = \frac{8}{10} = \frac{4}{5}$$

Écrivez une fraction pour chacun des modèles suivants.



$$\frac{4}{10} = \frac{2}{5}$$



$$\frac{9}{15} = \frac{3}{5}$$



$$\frac{16}{24} = \frac{2}{3}$$



$$\frac{18}{24} = \frac{3}{4}$$

$$\frac{2}{4} = \frac{1}{2}$$



$$\frac{12}{15} = \frac{4}{5}$$

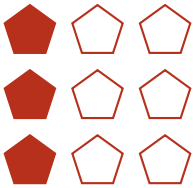

$$\frac{3}{9} = \frac{1}{3}$$

$$\frac{4}{20} = \frac{1}{5}$$