Modèles d'un Ensemble (G)



Dans cet ensemble il y a 24 figures et 12 sont coloriées.

$$\frac{\text{12 figures coloriées}}{\text{24 figures dans cet ensemble}} = \frac{12}{24} = \frac{1}{2}$$

Écrivez une fraction pour chacun des modèles suivants.