Modèles d'un Ensemble (C)



Dans cet ensemble il y a 15 figures et 12 sont coloriées.

$$\frac{\text{12 figures coloriées}}{\text{15 figures dans cet ensemble}} = \frac{12}{15} = \frac{4}{5}$$
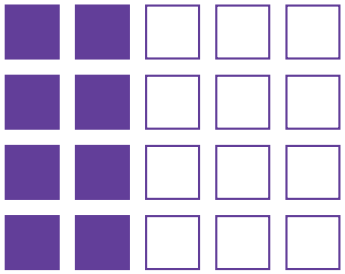
Écrivez une fraction pour chacun des modèles suivants.