# Modèles d'un Ensemble (B)

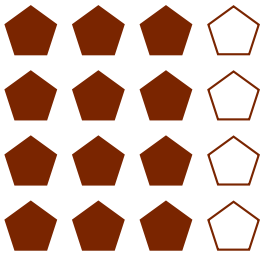

Dans cet ensemble il y a 16 figures et 12 sont coloriées.

$$\frac{\text{12 figures coloriées}}{\text{16 figures dans cet ensemble}} = \frac{12}{16} = \frac{3}{4}$$

Écrivez une fraction pour chacun des modèles suivants.





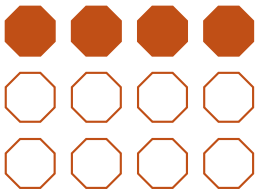









# Modèles d'un Ensemble (B) Réponses

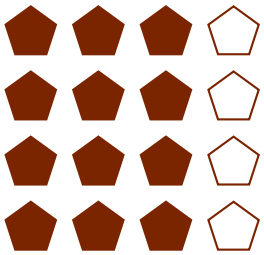

Dans cet ensemble il y a 16 figures et 12 sont coloriées.

$$\frac{\text{12 figures coloriées}}{\text{16 figures dans cet ensemble}} = \frac{12}{16} = \frac{3}{4}$$

Écrivez une fraction pour chacun des modèles suivants.



$$\frac{6}{24} = \frac{1}{4}$$



$$\frac{10}{15} = \frac{2}{3}$$

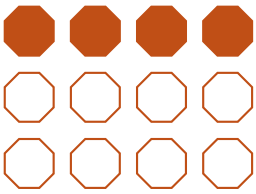

$$\frac{4}{12} = \frac{1}{3}$$

$$\frac{15}{18} = \frac{5}{6}$$



$$\frac{3}{15} = \frac{1}{5}$$



$$\frac{10}{20} = \frac{1}{2}$$



$$\frac{12}{15} = \frac{4}{5}$$



$$\frac{3}{18} = \frac{1}{6}$$