Modèles d'un Ensemble (J)

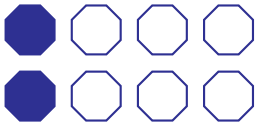

Dans cet ensemble il y a 8 figures et 2 sont coloriées.

$$\frac{\text{2 figures coloriées}}{\text{8 figures dans cet ensemble}} = \frac{2}{8} = \frac{1}{4}$$
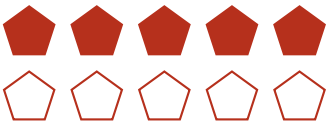
Écrivez une fraction pour chacun des modèles suivants.