Modèles d'un Ensemble (J)

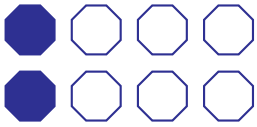

Dans cet ensemble il y a 8 figures et 2 sont coloriées.

$$\frac{\text{2 figures coloriées}}{\text{8 figures dans cet ensemble}} = \frac{2}{8} = \frac{1}{4}$$

Écrivez une fraction pour chacun des modèles suivants.



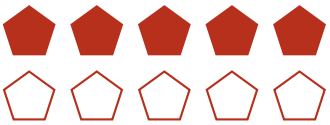







Modèles d'un Ensemble (J) Réponses

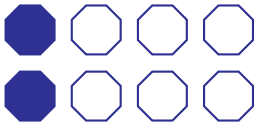

Dans cet ensemble il y a 8 figures et 2 sont coloriées.

$$\frac{\text{2 figures coloriées}}{\text{8 figures dans cet ensemble}} = \frac{2}{8} = \frac{1}{4}$$

Écrivez une fraction pour chacun des modèles suivants.



$$\frac{15}{18} = \frac{5}{6}$$

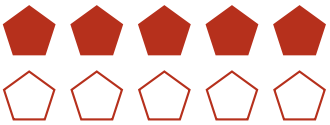

$$\frac{5}{10} = \frac{1}{2}$$



$$\frac{15}{20} = \frac{3}{4}$$

$$\frac{3}{18} = \frac{1}{6}$$

$$\frac{4}{10} = \frac{2}{5}$$

$$\frac{2}{3}$$



$$\frac{6}{10} = \frac{3}{5}$$



$$\frac{4}{12} = \frac{1}{3}$$