Modèles d'un Ensemble (H)



Dans cet ensemble
il y a 15 figures
et 5 sont coloriées.

$$\frac{\text{5 figures coloriées}}{\text{15 figures dans cet ensemble}} = \frac{5}{15} = \frac{1}{3}$$

Écrivez une fraction pour chacun des modèles suivants.









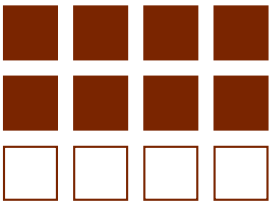

Modèles d'un Ensemble (H) Réponses



Dans cet ensemble
il y a 15 figures
et 5 sont coloriées.

$$\frac{\text{5 figures coloriées}}{\text{15 figures dans cet ensemble}} = \frac{5}{15} = \frac{1}{3}$$

Écrivez une fraction pour chacun des modèles suivants.

$$\frac{2}{5}$$



$$\frac{12}{15} = \frac{4}{5}$$

$$\frac{6}{18} = \frac{1}{3}$$



$$\frac{9}{12} = \frac{3}{4}$$



$$\frac{4}{24} = \frac{1}{6}$$

$$\frac{3}{6} = \frac{1}{2}$$



$$\frac{15}{24} = \frac{5}{8}$$



$$\frac{8}{12} = \frac{2}{3}$$