Modèles de Fractions (J)

Pour chaque modèle, colorez la portion du cercle représentée par la fraction associée.

1.

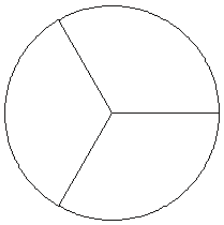

$\frac{1}{3}$

2.

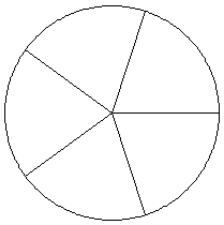

$\frac{2}{5}$

3.

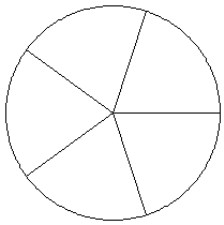

$\frac{2}{5}$

4.

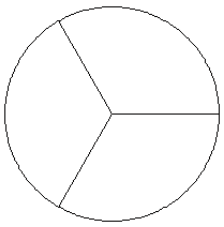

$\frac{2}{3}$

5.

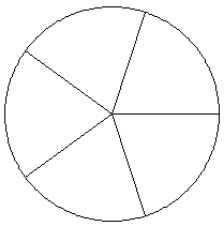

$\frac{2}{5}$

6.

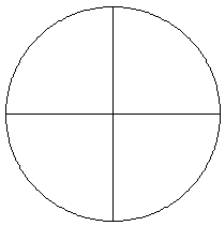

$\frac{1}{4}$

7.

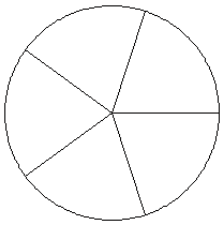

$\frac{2}{5}$

8.

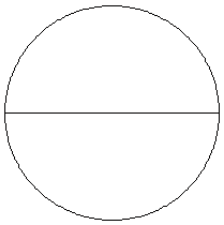

$\frac{0}{2}$

9.

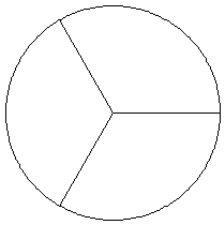

$\frac{2}{3}$

10.

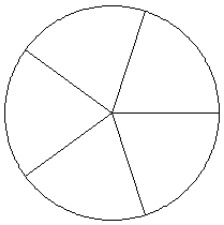

$\frac{3}{5}$

11.

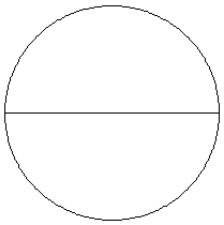

$\frac{2}{2}$

12.

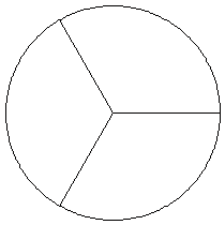

$\frac{2}{3}$