Modèles de Fractions (A)

Pour chaque modèle, colorez la portion du cercle représentée par la fraction associée.

1.

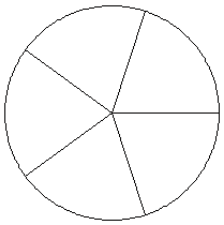

$\frac{3}{5}$

2.

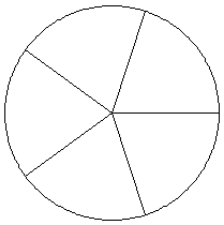

$\frac{0}{5}$

3.

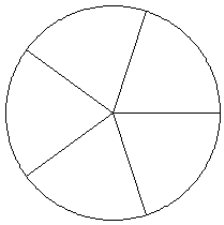

$\frac{1}{5}$

4.

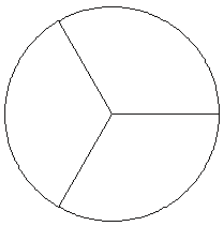

$\frac{2}{3}$

5.

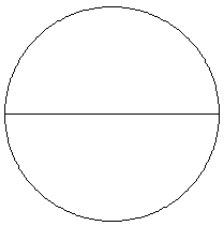

$\frac{2}{2}$

6.

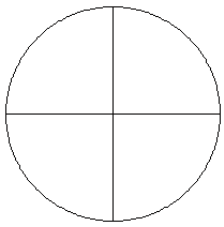

$\frac{4}{4}$

7.

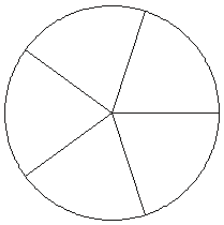

$\frac{2}{5}$

8.

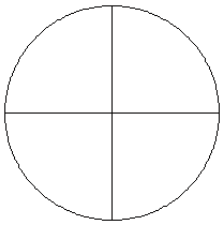

$\frac{2}{4}$

9.

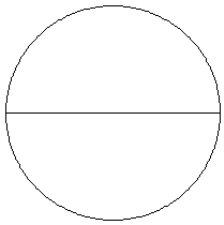

$\frac{0}{2}$

10.

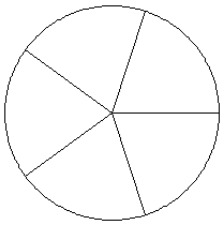

$\frac{3}{5}$

11.

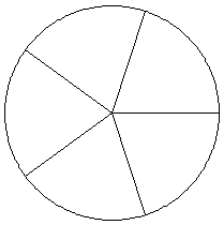

$\frac{3}{5}$

12.

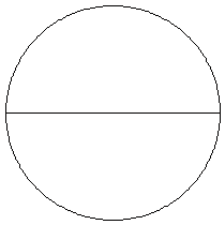

$\frac{2}{2}$