Modèles de Fractions (D)

Pour chaque modèle, colorez la portion du cercle représentée par la fraction associée.

1.

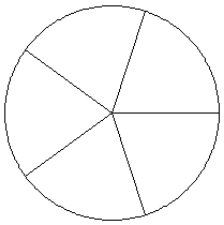

$\frac{3}{5}$

2.

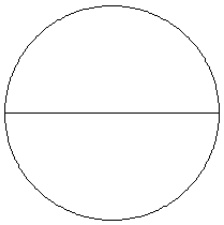

$\frac{1}{2}$

3.

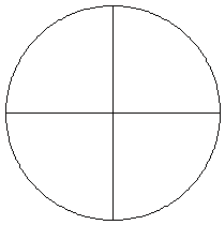

$\frac{1}{4}$

4.

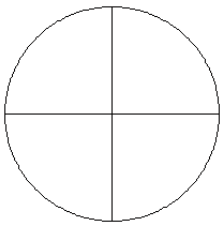

$\frac{2}{4}$

5.

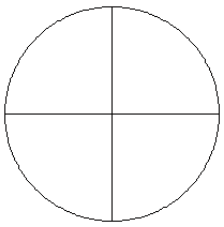

$\frac{1}{4}$

6.

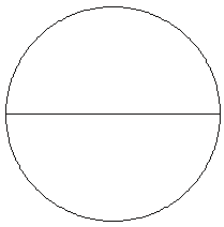

$\frac{1}{2}$

7.

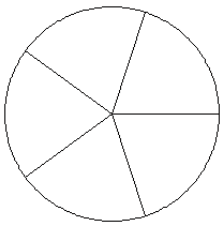

$\frac{2}{5}$

8.

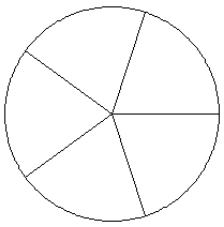

$\frac{2}{5}$

9.

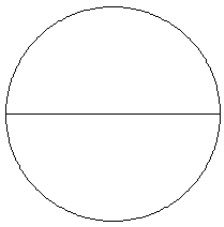

$\frac{1}{2}$

10.

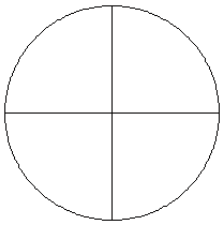

$\frac{3}{4}$

11.

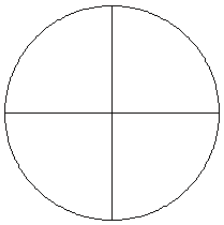

$\frac{2}{4}$

12.

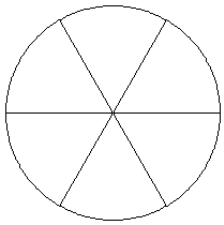

$\frac{3}{6}$