Modèles de Fractions (H)

Pour chaque modèle, colorez la portion du cercle représentée par la fraction associée.

1.

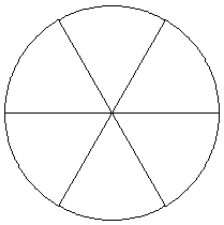

$\frac{2}{6}$

2.

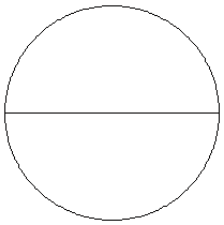

$\frac{0}{2}$

3.

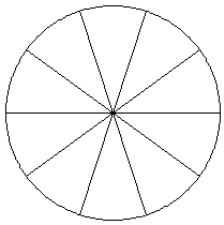

$\frac{5}{10}$

4.

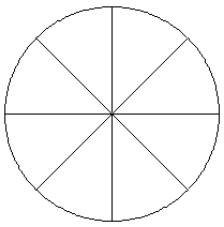

$\frac{5}{8}$

5.

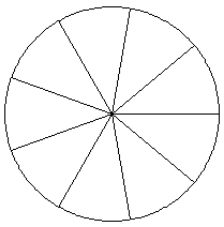

$\frac{1}{9}$

6.

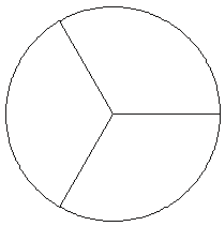

$\frac{1}{3}$

7.

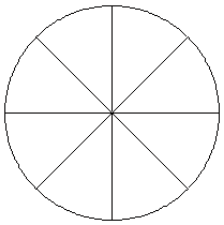

$\frac{2}{8}$

8.

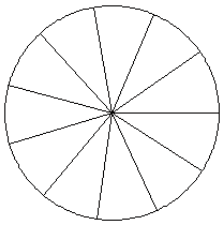

$\frac{3}{11}$

9.

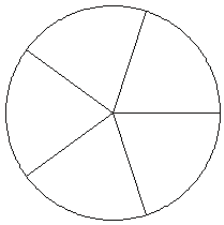

$\frac{1}{5}$

10.

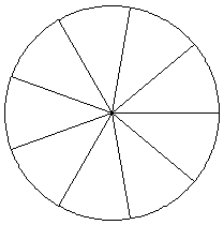

$\frac{4}{9}$

11.

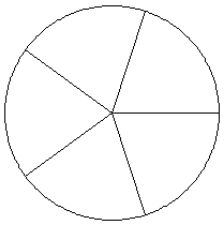

$\frac{1}{5}$

12.

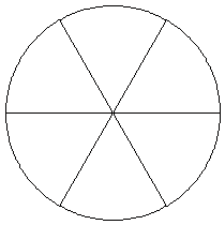

$\frac{3}{6}$