Modèles de Fractions (F)

Pour chaque modèle, colorez la portion du cercle représentée par la fraction associée.

1.

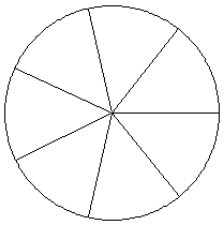

$\frac{5}{7}$

2.

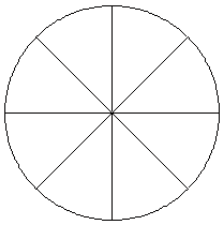

$\frac{5}{8}$

3.

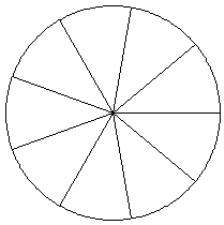

$\frac{3}{9}$

4.

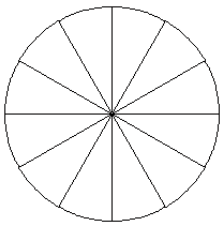

$\frac{9}{12}$

5.

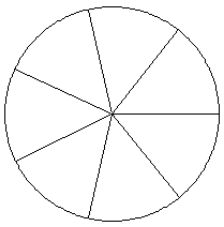

$\frac{4}{7}$

6.

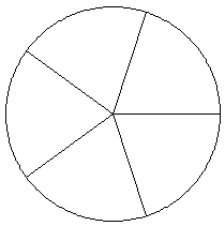

$\frac{3}{5}$

7.

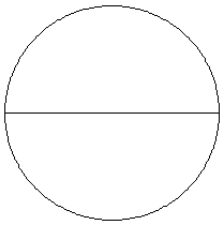

$\frac{2}{2}$

8.

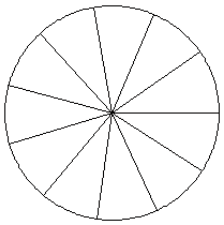

$\frac{8}{11}$

9.

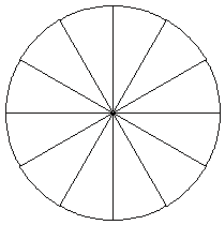

$\frac{5}{12}$

10.

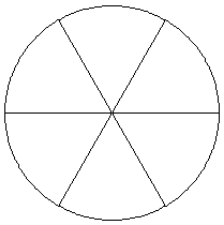

$\frac{4}{6}$

11.

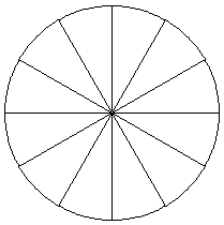

$\frac{2}{12}$

12.

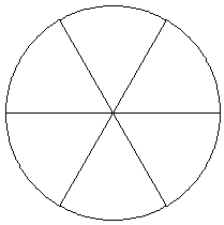

$\frac{3}{6}$