Modèles de Fractions (D)

Quelle fraction représente chaque modèle?

1.

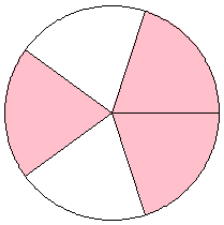

2.

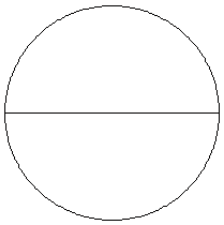

3.

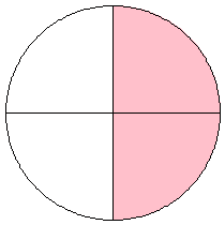

4.

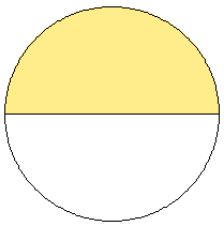

5.

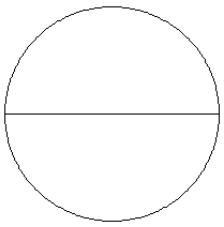

6.

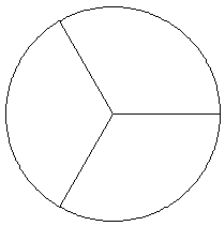

7.

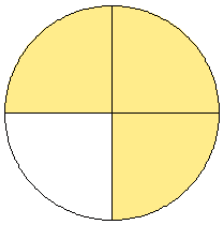

8.

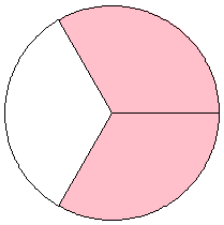

9.

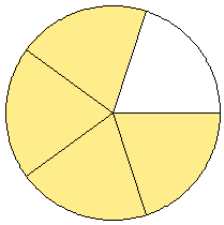

10.

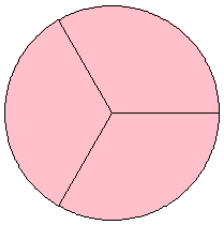

11.

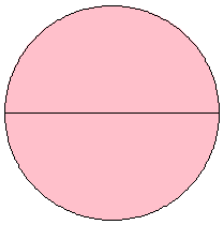

12.

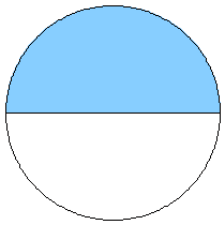

Modèles de Fractions (D) Solutions

Quelle fraction représente chaque modèle?

1.

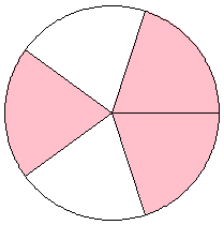

$= \frac{3}{5}$

2.

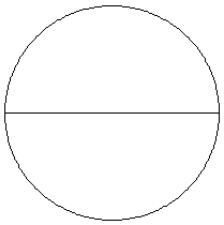

$= \frac{0}{2}$

3.

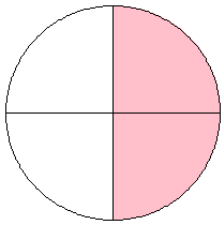

$= \frac{2}{4}$

4.

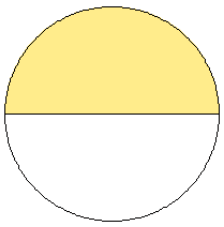

$= \frac{1}{2}$

5.

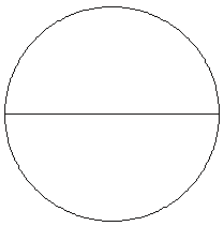

$= \frac{0}{2}$

6.

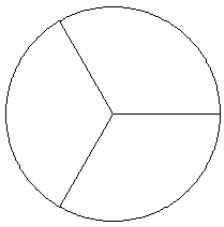

$= \frac{0}{3}$

7.

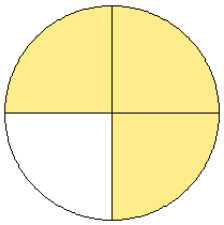

$= \frac{3}{4}$

8.

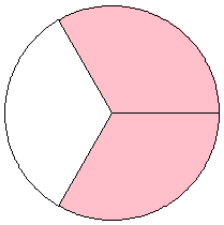

$= \frac{2}{3}$

9.

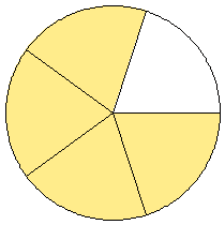

$= \frac{4}{5}$

10.

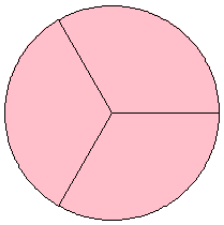

$= \frac{3}{3}$

11.

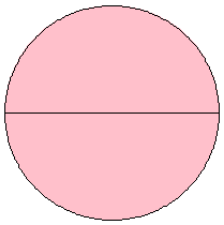

$= \frac{2}{2}$

12.

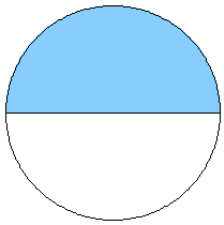

$= \frac{1}{2}$