Parts d'un Ensemble (E)



$\frac{2}{6}$ carrés ombragés
carrés dans l'ensemble

Pour chaque ensemble, écrivez la portion de l'ensemble qui est ombragé.

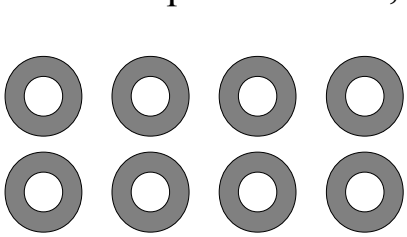

___

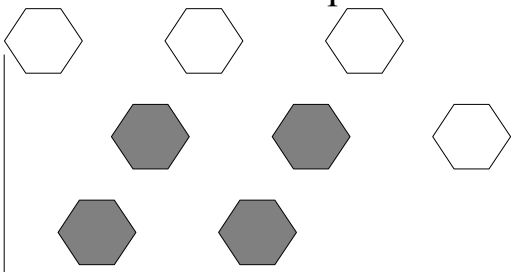

___



___

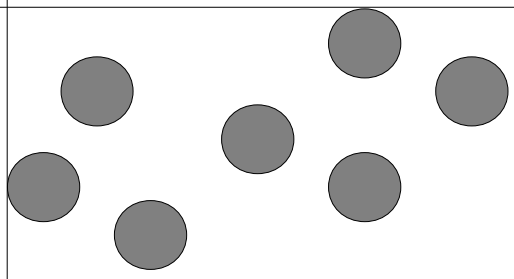

___

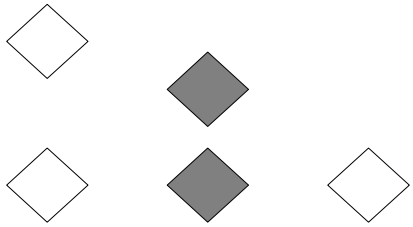

___

___



___

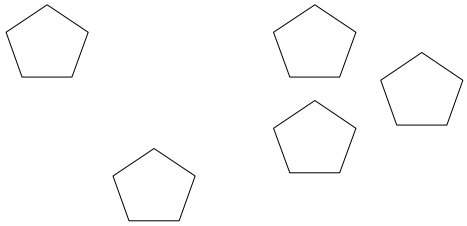

___

Thomas broke his crayon and colored none of the six crosses. What fraction could he write? ___