Parts d'un Ensemble (E)



$\frac{2}{6}$ carrés ombragés
carrés dans l'ensemble

Pour chaque ensemble, écrivez la portion de l'ensemble qui est ombragé.

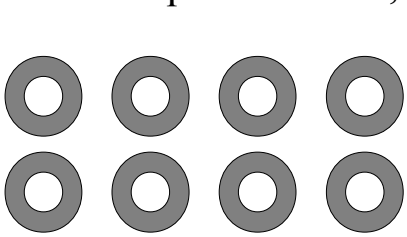

___

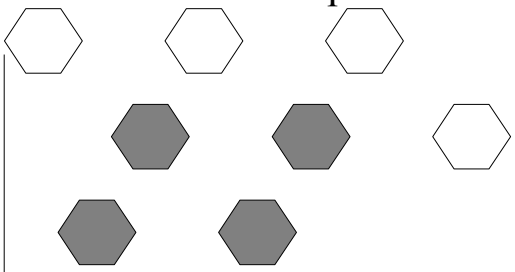

___



___

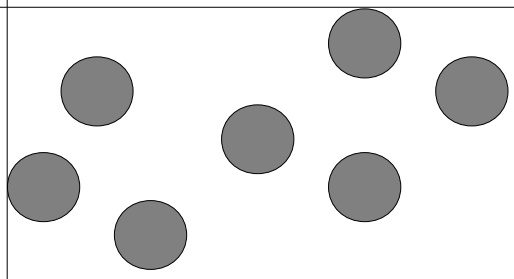

___

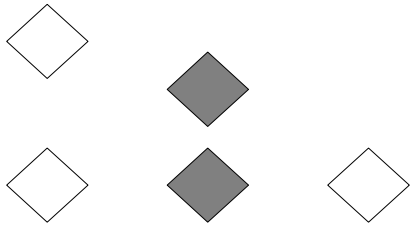

___

___



___

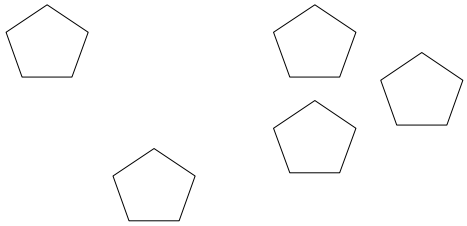

___

Thomas broke his crayon and colored none of the six crosses. What fraction could he write? ___

Parts d'un Ensemble (E) Solutions



$\frac{2}{6}$ carrés ombragés
carrés dans l'ensemble

Pour chaque ensemble, écrivez la portion de l'ensemble qui est ombragé.

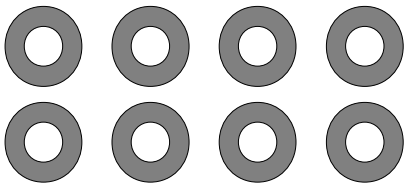

$\frac{8}{8}$

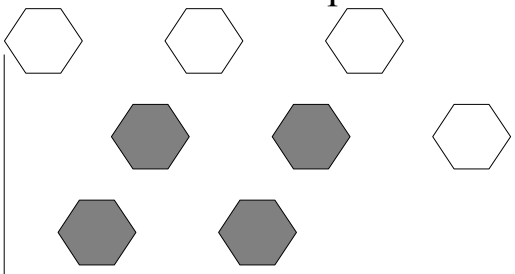

$\frac{4}{8}$



$\frac{1}{4}$

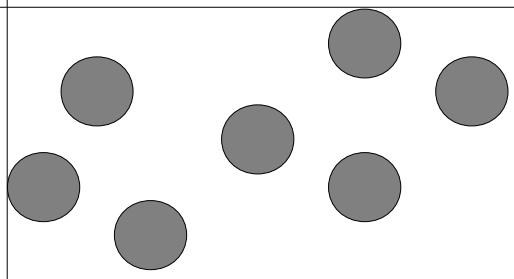

$\frac{7}{7}$

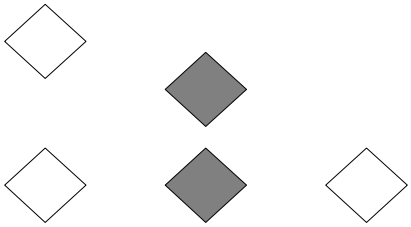

$\frac{2}{5}$

$\frac{4}{5}$



$\frac{6}{9}$

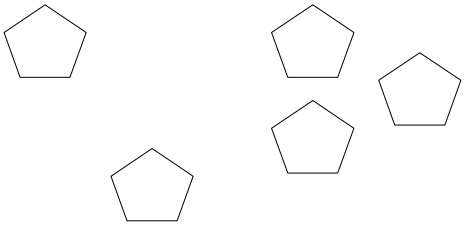

$\frac{0}{5}$

Thomas broke his crayon and colored none of the six crosses. What fraction could he write? $\frac{0}{6}$