Modèles de Sixièmes (D)

Instructions: Représentez chaque fractions en colorant les sections appropriées du modèle correspondant. Essayez de représenter les mêmes fractions de façons différentes.

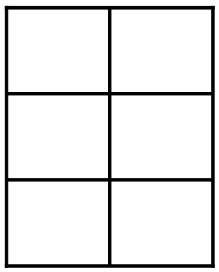

$\frac{2}{6}$

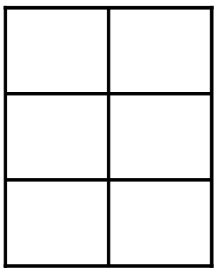

$\frac{2}{6}$

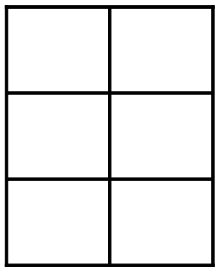

$\frac{1}{6}$

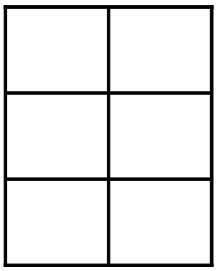

$\frac{2}{6}$

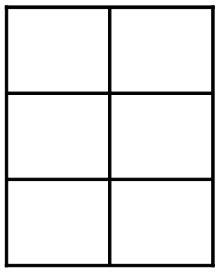

$\frac{2}{6}$

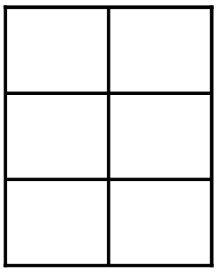

$\frac{2}{6}$

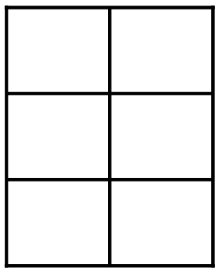

$\frac{4}{6}$

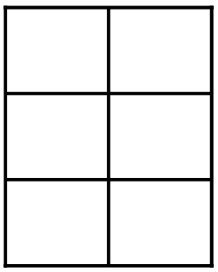

$\frac{4}{6}$

Modèles de Sixièmes (D) Solutions

Instructions: Représentez chaque fractions en colorant les sections appropriées du modèle correspondant. Essayez de représenter les mêmes fractions de façons différentes.

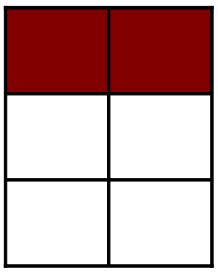

$\frac{2}{6}$

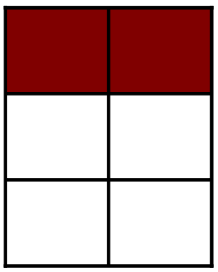

$\frac{2}{6}$



$\frac{1}{6}$

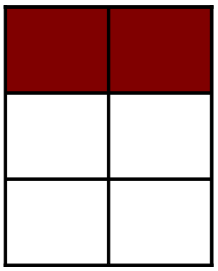

$\frac{2}{6}$



$\frac{2}{6}$

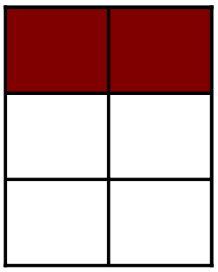

$\frac{2}{6}$

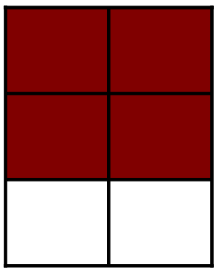

$\frac{4}{6}$

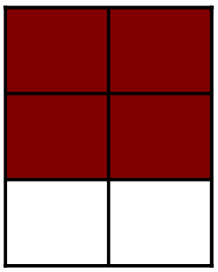

$\frac{4}{6}$