Représentation de Nombres (J)

Quel chiffre est représenté par chaque groupe de blocs d'unité?

1

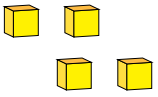

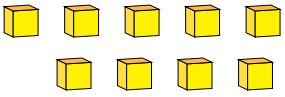

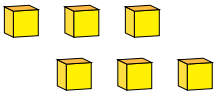

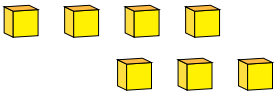

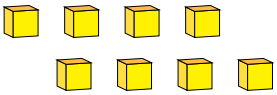

Représentation de Nombres (J) Réponses

Quel chiffre est représenté par chaque groupe de blocs d'unité?

1

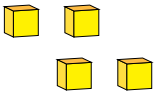

4

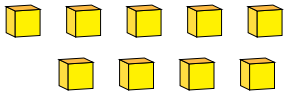

9

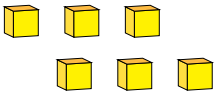

6

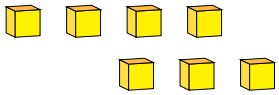

7

1

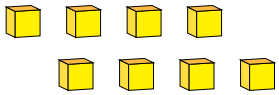

8