Représentation de Nombres (H)

Quel chiffre est représenté par chaque groupe de blocs d'unité?

1

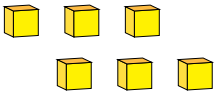

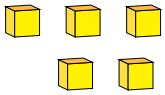

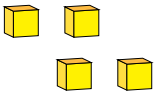

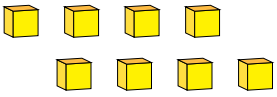

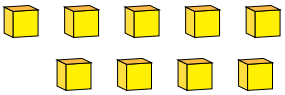

Représentation de Nombres (H) Réponses

Quel chiffre est représenté par chaque groupe de blocs d'unité?

1

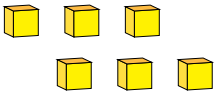

6

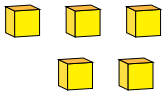

5

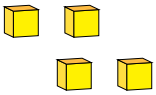

4

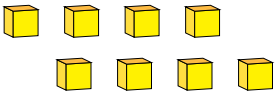

8

2

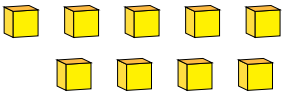

9