# Échange de Blocs de Base Dix (G)

Combien de dizaines pouvez-vous échanger pour des centaines? Combien vous en restera-t-il?

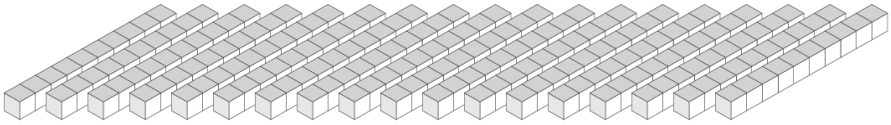

| Centaines | Dizaines |
|---|---|
| | |

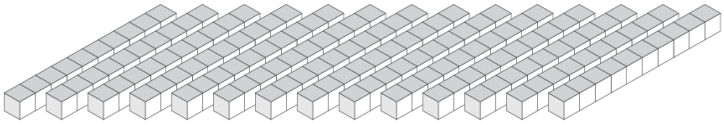

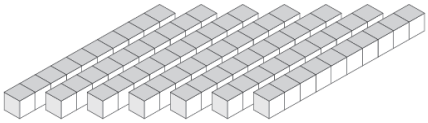

| Centaines | Dizaines |
|---|---|
| | |

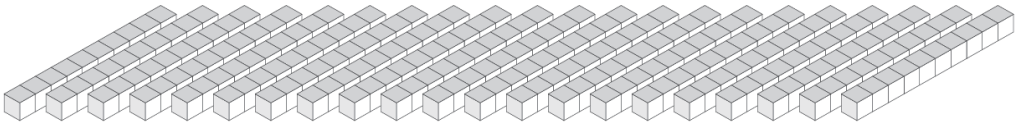

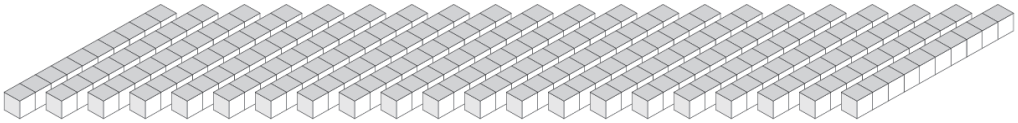

| Centaines | Dizaines |
|---|---|
| | |

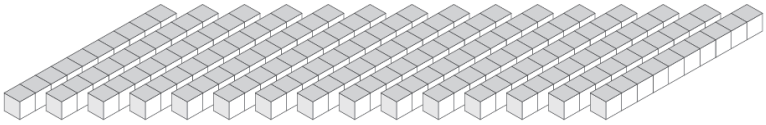

| Centaines | Dizaines |
|---|---|
| | |

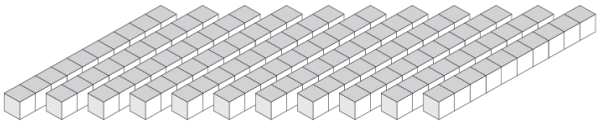

| Centaines | Dizaines |
|---|---|
| | |

# Échange de Blocs de Base Dix (G) Solutions

Combien de dizaines pouvez-vous échanger pour des centaines? Combien vous en restera-t-il?

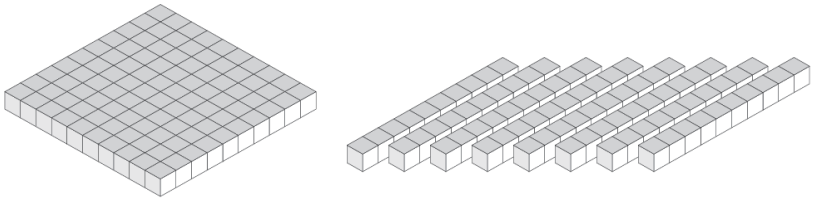

| Centaines | Dizaines |
|---|---|
| 1 | 8 |

---

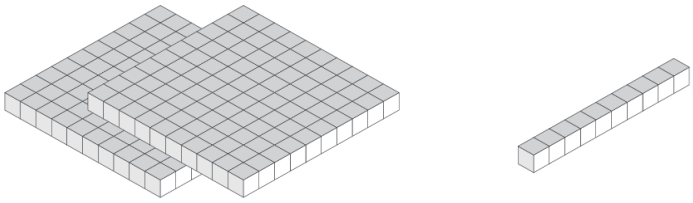

| Centaines | Dizaines |
|---|---|
| 2 | 1 |

---

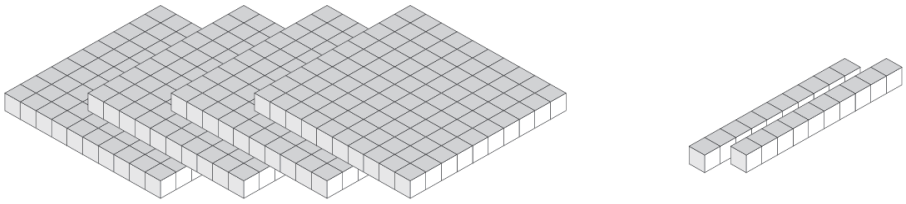

| Centaines | Dizaines |
|---|---|
| 4 | 2 |

---

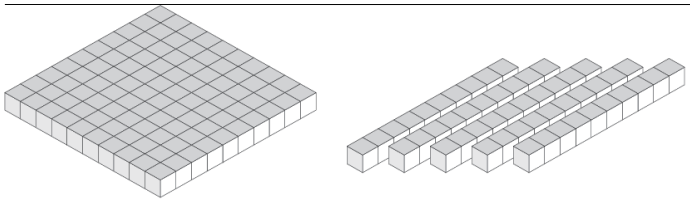

| Centaines | Dizaines |
|---|---|
| 1 | 5 |

---

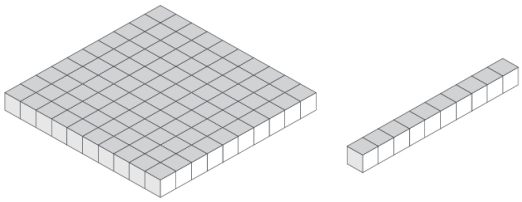

| Centaines | Dizaines |
|---|---|
| 1 | 1 |

0