Représentation Graphique d'une Inéquation (G)

Représentez sur une droite graduée la solution de l'inéquation suivante.

1. $x < 7$

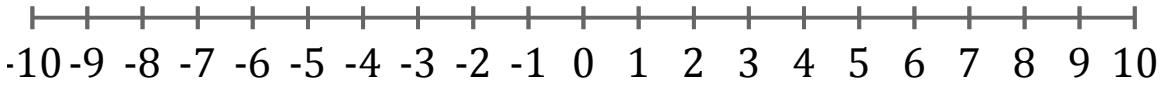

2. $x \leq 5$

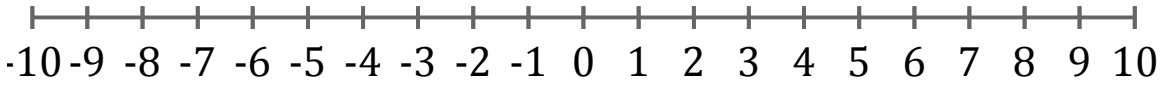

3. $x \geq 6$

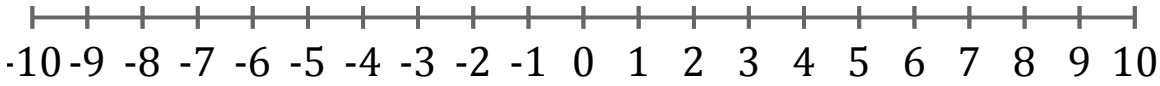

4. $x > 2$

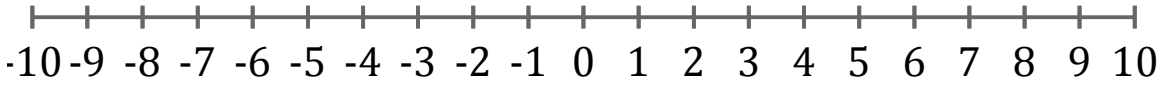
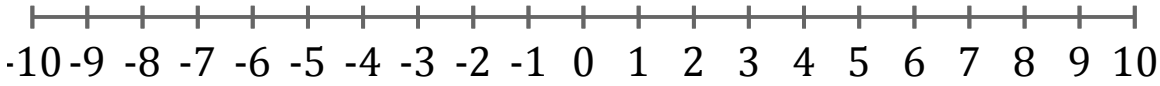
5. $x \geq 2$