Représentation Graphique d'une Inéquation (E)

Représentez sur une droite graduée la solution de l'inéquation suivante.

1. $x > -8$

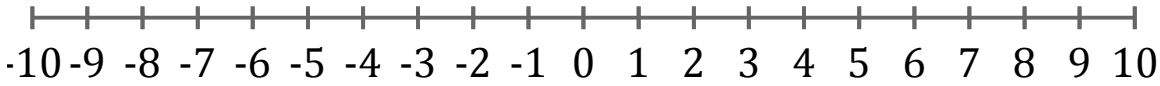

2. $x < -4$

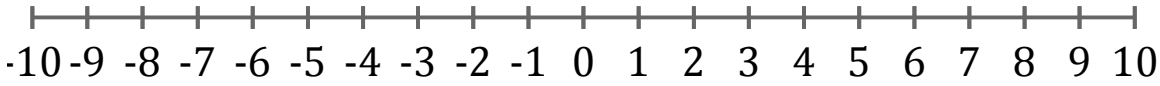

3. $x \leq 6$

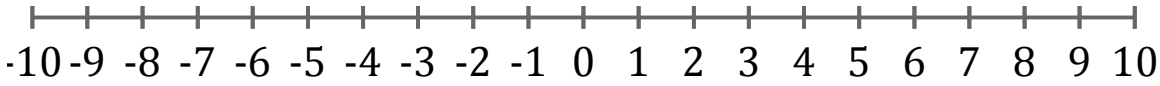

4. $x < -3$

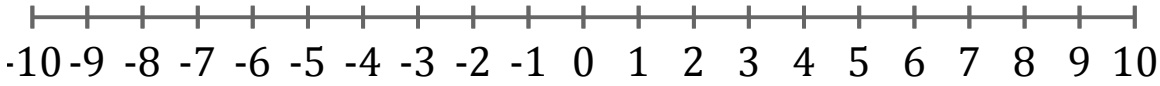
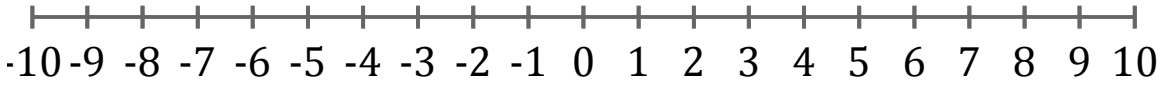
5. $x \geq 4$